Year 1 Maths Homework

Due: Monday 30th September

Count.

Then write a sentence to describe the objects using the words **more, fewer** or **as many**.



_____

_____

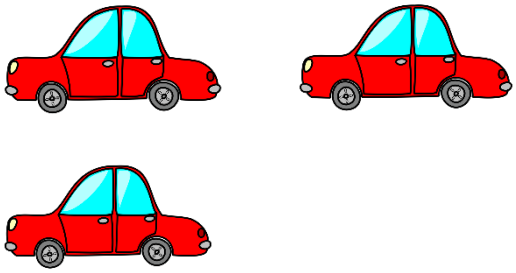



_____

_____

_____

_____

Challenge: Draw some of your own objects and write sentences about them using **more, fewer and as many**.